201306H1261

higher education & training

Department:
Higher Education and Training
REPUBLIC OF SOUTH AFRICA

N1410(E)(M31)H
JUNE EXAMINATION

NATIONAL CERTIFICATE

TOURIST DESTINATIONS N4

(22030044)

31 May 2013 (X-Paper)
09:00–12:00

This question paper consists of 22 pages and 1 addendum.

Copyright reserved

DEPARTMENT OF HIGHER EDUCATION AND TRAINING
REPUBLIC OF SOUTH AFRICA

NATIONAL CERTIFICATE
TOURIST DESTINATIONS N4
TIME: 3 HOURS
MARKS: 200

INSTRUCTIONS AND INFORMATION

1. This question paper consists of TWO sections: SECTION A and SECTION B.
2. SECTION A is COMPULSORY with a total of 40 marks.
3. SECTION B consists of five questions of which FOUR must be answered. The total for these four questions is 160 marks.
4. Read ALL the questions carefully.
5. Number the answers according to the numbering system used in this question paper.
6. Start each question on a NEW page.
7. Write neatly and legibly.

Copyright reserved

SECTION A (COMPULSORY)

QUESTION 1

Use the map of South Africa ADDENDUM A (attached), as well as the atlas to answer the following questions.

1.1 Identify the type of map attached. (1)

1.2 What kind of information can be obtained from this map? (2)

1.3 State TWO uses of this map. (2)

1.4 Refer to ADDENDUM A (attached), to identify the provinces using the following readings. Write only the name of the province next to the question number (1.4.1–1.4.2) in the ANSWER BOOK.

1.4.1 30° S 20° E (2)
1.4.2 30° S 30° E (2)

1.5 Identify the type of scale included on the map. (1)

1.6 Explain how the scale, identified in QUESTION 1.5, is used. (1)

1.7 Draw the conventional map symbols for the following:

1.7.1 International boundary (1)
1.7.2 Town or village (1)

1.8 Name ONE of the conventional map symbol categories. (1)

1.9 Refer to the map ADDENDUM A (attached), to complete the following sentences:

1.9.1 Kimberley is ... (direction) of Bloemfontein. (1)
1.9.2 George is ... (direction) of Oudtshoorn. (1)

1.10 Mr and Mrs Merk from Switzerland are in South Africa for their annual break-away. The tourist office at OR Tambo provided them with the map of South Africa ADDENDUM A (attached) to plan their trip. They are travelling by car from Cape Town to Bloemfontein along the national road.

1.10.1 What is the number of this national road? (1)

1.10.2 How many kilometres will the tourists travel before they reach Port Elizabeth? Use the scale given in ADDENDUM A (attached), to calculate the distance. (2)

1.10.3 Give the name of the capital city of the province that lies between the Western Cape and KwaZulu-Natal. (1)

1.11 Use the map ADDENDUM A (attached) and identify the symbols marked (A–E). (5)
[25]

Copyright reserved

QUESTION 2: SOUTHERN AND SOUTH AFRICA

Use the atlas and learning material to answer the following questions.

2.1 Name the national flower of South Africa. (1)

2.2 Name THREE of the countries that border South Africa. (3)

2.3 Identify the following World Heritage Sites in South Africa. Write only the answer next to the question number (2.3.1–2.3.2) in the ANSWER BOOK.

2.3.1



(1)

2.3.2



(1)

2.4 Name the TWO coach services that operate nationally in South Africa. (2)

2.5 South Africa is split into three rainfall areas. Name the THREE areas. (3)

2.6 South Africa's unit of currency is called rand. Where does the term 'rand' come from? (1)

2.7 Which ONE of the eleven official languages is most widely spoken in South Africa? (2)

2.8 Which public holiday is celebrated annually on 16 December in South Africa? (1)
[15]

TOTAL SECTION A: 40

Copyright reserved

SECTION B

QUESTION 3

Answer any FOUR of the five questions in this section.

3.1 Complete the following sentences by filling in the missing word(s). Write only the word(s) next to the question number (3.1.1–3.1.7) in the ANSWER BOOK.

3.1.1 Limpopo Province consists of the Waterberg, ..., Vhembe, Capricorn and Sekhukhune Tourist regions. (1)

3.1.2 The Free State Province is known as the ... of South Africa as its more than 30 000 farms producing more than ...% of South Africa's grain. (2)

3.1.3 The collective name for the Sand River Mountains, the Hoekberg, the Swaershoek Mountains and the Moepel range in Limpopo is .... (1)

3.1.4 The North-West Heritage Park consists of the ... National Park and the ... Game Reserve. (2)

3.1.5 The town, ..., in the Northern Cape is known for its dates that are sent all over South Africa. (1)

3.1.6 The town Mookgophong in Limpopo was originally established as a result of a ... and originally named after the .... (2)

3.1.7 The highest point in the Golden Gate National Park is .... (1)

3.2 Choose an item from COLUMN B that matches a town in COLUMN A. Write only the letter (A–H) next to the question number (3.2.1–3.2.5) in the ANSWER BOOK.

COLUMN A		COLUMN A	
3.2.1	Oudtshoorn	A	Oppikoppi Bushveld Festival
3.2.2	Grahamstown	B	Innibos
3.2.3	Northam	C	Klein Karoo Arts Festival
3.2.4	Franschhoek	D	Herman Charles Bosman Festival
3.2.5	Nelspruit	E	BookEx
		F	National Arts Festival
		G	Literary Festival
		H	International Jazz Festival

(5 × 2) (10)

Copyright reserved

3.3 You work for Going West Travel Agency in Cape Town. Mr Li Nan contacted the agency and asked you to prepare a five-day itinerary for himself, his wife and two children. They are from China and would like to visit the following towns/cities:

Cape Town, Stellenbosch, Hermanus, and Paarl

3.3.1 At which international airport will they arrive if they fly directly from China to the Western Cape? (1)

3.3.2 Name THREE aspects that you would consider when you plan the itinerary. (3)

3.3.3 Mr Nan indicated that he read about the natural attractions of Hermanus and would like you to include only natural attractions on their itinerary for the day that they will spend in Hermanus. Name THREE natural attractions that you will include in the itinerary. (3)

3.3.4 The Nan children would like to do some shopping while they are in Cape Town. Name TWO shopping centres in Cape Town that you can recommend. (2)

3.3.5 The Nan family would also like to know more about the history of the Afrikaans language. Which monument will you include in their tour to fulfil this need? (1)

3.3.6 Compile a one-day itinerary for the Nan family for their visit to Stellenbosch.

Mark allocation will be as follows:

- Organisation of itinerary (1)
- Identification of at least FOUR places of interest (4)
- Provision for meals and breaks (1)
- Management of time (2)
- Provision of additional information such as safety and security tips (2)

[40]

QUESTION 4

4.1 Bloemfontein is a city with various museums. Name THREE museums situated in Bloemfontein. (3)

4.2 Name TWO main agricultural products that are produced in the Free State. (2)

4.3 You have to advise tourists regarding cultural attractions in Welkom. Name FIVE cultural attractions in and around Welkom. (5)

Copyright reserved

4.4 Explain the following attractions and name the town in which you will find each:

4.4.1 Ou Grietjie (2)

4.4.2 Florisbad Skull (2)

4.4.3 Queen Victoria (2)

4.4.4 Kinderlê (2)

4.4.5 The Eye (2)

4.5 Refer to the extract of an itinerary below and answer the questions that follow:

SAFARI, FOREST AND BEACH TOUR

Highlights

- Go on a walking safari with your armed ranger in the Kruger.
- Overnight in the exciting sleep out tents at Plains Camp.
- Dolphin and whale speedboat excursion at Thonga.
- Guided canoe trip on the lake systems around Kosi Forest Lodge.

The Journey

This is one of the best packages on offer in South Africa, combining a conventional game drive experience in the Kruger with a walking safari before heading on down to South Africa's stunning Indian Ocean coastline. Air charters between lodges maximize your holiday time and minimize the time you would normally spend travelling. Highly recommended for those wanting to combine activity and relaxation.

Itinerary

Day 1 - 3 - Rhino Post Safari Lodge, Kruger Park

Day 3 - 5 - Plains Camp, Kruger Park

Day 5 -7 - Thonga Beach Lodge, Kwazulu Natal

Day 7- 9 - Kosi Forest Lodge, Kwazulu Natal Coast

Day 9 - End of tour

Includes

- All flights and transfers as stated
- 2 nights at Rhino Post Safari Lodge on a full board basis to include all meals and game viewing activities
- 2 nights at Plains Camp on a full board basis to include all meals and game viewing activities
- 2 nights at Thonga Beach lodge on a full board basis to include snorkeling, forest walk, cultural tour and kayaking on Lake Sibaya
- 2 nights at Kosi Forest Lodge on a full board basis including guided canoeing, Raffia forest walks and guided boat trip on the lakes system
- Park Fees

Copyright reserved

Excludes

- International flights
- Items of a personal nature
- All meals not specified
- Gratuities
- Travel Insurance
- Visas

Facts

Duration: 8 nights
Begins: Johannesburg
Ends: Johannesburg

4.5.1 Name THREE means of transport that will be used during this trip. (3)

4.5.2 Accommodation at most of the lodges is on a full board basis. Explain the term *full board*. (1)

4.5.3 Name the TWO provinces that will be visited during this tour. (2)

4.5.4 Identify the airport where international tourists will arrive in South Africa for this itinerary. (1)

4.5.5 Name THREE activities that tourists will enjoy during this tour. (3)

4.5.6 Identify the type of client that will enjoy the Safari, beach and forest tour. (2)

Copyright reserved

4.5.7 Lake Sibaya and Kosi forest are situated in the … National Park. (1)

4.5.8 Explain what the term *gratuities* means. (1)

4.5.9 Name THREE of the big six trees that tourists will see in Kruger National Park. (3)

4.5.10 One of the tourists on the tour decides to extend his/her stay by spending another two days in Johannesburg. He/She asks you to be his/her tourist guide and indicates that he wants to see some of the cultural attractions in Johannesburg. You decide to take him/her to the following three attractions:

(a) Enoch Sontonga Memorial

(b) Gold Reef City

(c) Museum Africa

Give ONE reason why each one of these attractions justifies a visit. (3)
[40]

QUESTION 5

5.1 Indicate whether the following statements are TRUE or FALSE. Choose the answer and write only 'true' or 'false' next to the question number (5.1.1–5.1.10) in the ANSWER BOOK.

5.1.1 Lake St Lucia is the largest estuarine system in Africa and acts as a nursery to countless marine species.

5.1.2 EThekwini, the Zulu name for Durban means the place where the ocean and the sky meet

5.1.3 The town Tongaat was established to provide a home for the sugar industry labour force.

5.1.4 The Raffia Palm monument is situated in Melmoth.

5.1.5 The Sardine Run takes place every year between February and March.

5.1.6 Oviston was built to house the workforce that built the Orange-Fish River tunnel, the world's longest irrigation tunnel.

5.1.7 Teebus and Koffiebus are two monuments erected to commemorate the importance of agriculture in the Steynsburg area.

Copyright reserved

5.1.8 A Big Apple statue can be found in Bathurst.

5.1.9 The oldest National Arts Festival takes place in King Williams Town every year.

5.1.10 The Big Seven can be seen in the Addo Elephant National Park.

(10 × 1) (10)

5.2 Various options are given as possible answers to the following questions. Choose the answer and write only the letter (A–D) next to the question number (5.2.1–5.2.10) in the ANSWER BOOK.

5.2.1 The town Coligny was initially known as …

A Welverdiend.
B Barberspan.
C Treurfontein.
D Witfontein.

5.2.2 Monate Citrus Cellars, one of just four in South Africa, is situated near …

A Rustenburg.
B Hartebeespoort.
C Koster.
D Potchefstoom.

5.2.3 The town … was established as a result of the discovery of diamonds.

A Christiana
B Bloemhof
C Groot Marico
D Kroondal

5.2.4 The house of the poet JD du Toit can be found in …

A Klerksdorp.
B Ottosdal.
C Brits.
D Potchefstroom.

5.2.5 The town Makwassie was named after a …

A plant.
B animal.
C person.
D star.

Copyright reserved

5.2.6 The Elephant Museum is situated in the ... camp in the Kruger National Park.

A Skukuza
B Letaba
C Satara
D Mopani

5.2.7 The coal-derived oil production plants SASOL 2 and 3 are situated in ...

A Evander.
B Carolina.
C Kinross.
D Secunda.

5.2.8 A memorial on the spot where the Mozambican President Samora Machel died in a plane crash, is near ...

A Lydenburg.
B Komatipoort.
C Sabie.
D Malelane.

5.2.9 One of the major tourist attractions in ... is bird-watching.

A Volksrust
B Wakkerstroom
C Ermelo
D Chrissiesmeer

5.2.10 Barberton is known for its unique ...

A daisy.
B protea.
C rose.
D oak tree.

(10 × 1) (10)

Copyright reserved

5.3 Read the itinerary below and answer the questions that follow:

KwaZulu-Natal and Zululand Tour Itinerary

KwaZulu-natal and Zululand
(Guided tour for the active/adventurous)

Regarded as the most diverse province of South Africa, KwaZulu-Natal is known as the Kingdom of The Zulu. This is a landscape that has inspired the adventurous traveller to explore and discover since white man first landed here 400 years ago. We explore the majestic Drakensberg Mountains at their most spectacular. See the rock art legacy left by the San, which has resulted in the proclamation of the area as a World Heritage Site. Share the hospitality and learn the traditional customs of a Zulu family. Walk the ancient rhino paths of one of Africa's oldest game reserves, Hluhluwe/Umfolozi Park. Visit the Greater St. Lucia Wetland Park, the first area to be proclaimed a World Heritage site in South Africa.







Days 1 - 4 Southern Drakensberg
From Durban we make for the Southern Drakensberg where a tribal community has developed a series of hiking chalets on the slopes of the mountain. Friendly smiling hosts will make you feel immediately welcome and at home. The route takes us along a contour path, crossing mountain streams and scrambling up to caves formerly inhabited by Bushmen. The end of each day finds us at another chalet in an ideal setting and serviced by friendly hosts.
Overnight: Mehloding Hiking Trail (FB)

Day 5 Howick
Making our way through the rolling foothills of the Drakensberg, our overnight destination is in the picturesque Midlands area.
Overnight: Howick (B & D)

Day 6 Howick
Start the day off with a slide through indigenous forest at canopy level with Karkloof Canopy Tours www.karkloofcanopytours.co.za

Optional extra's one can also do in and around the Midlands:

- Nature walks in local reserves
- Birding
- Mountain Biking
- Midlands Meander

www.midlandsmeander.co.za

Overnight: Howick (B & D)

Copyright reserved









Days 7 & 8 Eshowe

Few tourists have had the privilege of exploring today's route via the most rural and inaccessible parts of the Zulu Kingdom. Finally we arrive in the highlands of Zululand where we are guests at a traditional rural Zulu homestead. This unique African Insight experience includes a walk in the forest with the local Nyanga (herbalist) and a visit to the local Sangoma (Spiritual Healer). If there is a traditional ceremony of any sort happening in the area we will be invited to participate, another unique opportunity experienced by few international visitors.

Overnight: eKhuthuleni Zulu Home Stay (FB)

Days 9 - 11 Hluhluwe/Umfolozi Game Reserve

Nearby is Hluhluwe / Umfolozi Park, one of the oldest game reserves and wilderness areas in Africa. This is big game country where the white rhino was saved from extinction, today the park has the largest concentrations of both rhino species as well as plenty elephant, lion, buffalo and all the common species of game.

Unlike the average tourist, who will book into one of the luxury camps, we are heading off into the wilderness (25 000ha) on foot for 3 nights on one of the last true wilderness experiences left in Africa.

Overnight: Umfolozi Wilderness Trail (FB)

Days 12 & 13 Tembe Elephant Park

We make our way to the Mozambique border and the last free-ranging herd of in the Tembe Elephant Park. Spend 2 nights in a tented safari camp enjoying open safari vehicle game drives, visiting the water holes which are magnets for wildlife in this water-poor area.

Overnight: Tembe Elephant Park (FB)

Day 14 Kosi Bay

A short drive to the border town of Kangwanase where we take a 4 x 4 trip to the mouth of the Kosi Lake estuarine system, where the Tonga tribe have practised sustainable fish trapping for

Copyright reserved

400 years. The rest of the day we have to relax on the beach and snorkel in the safe waters of the lagoon.

Overnight: Kosi Bay (FB)

Day 15 Return home

The dawn chorus of birds breaks the stillness of the forest and the alarm calls of the sentinels alert the rest of the monkey troop as we kayak through the narrow papyrus lined channels pristine of the forest. After breakfast we pack up and head back to Durban airport arriving towards the late afternoon.

END OF AFRICAN INSIGHT ARRANGEMENTS

FROM:	R35 450.00	per person
SINGLE SUPPLEMENT:	R5 400.00	

The above price is based on 4 adults travelling with a guide

**B – Breakfast*
**L – Lunch*
**D – Dinner*
**FB – Full Board (B, L & D)*

INCLUDES:

African Insight English speaking guide
Transport
Accommodation
Meals as specified
Park Entrance Fees
Bed levies and community levies where applicable

EXCLUDES:

All Flights
Items of a personal nature
Tips and gratuities
Optional extra activities
Travel and medical insurance
Drinks not supplied by African Insight

Copyright reserved

5.3.1 Name TWO World Heritage Sites that will be visited during this tour. (2)

5.3.2 This itinerary covers both the cultural and natural interests of the area. Identify TWO cultural groups that will be visited during the tour. (2)

5.3.3 The needs of tourists who are interested in adventure activities will also be fulfilled by this itinerary. Explain why you agree/disagree with this statement. (2)

5.3.4 Define the term *optional extras*. (1)

5.3.5 What is the meaning of the abbreviation FB? (1)

5.3.6 During the visit to Howick some of the tourists indicated that they would like to visit cultural attractions in and around Howick. Name FOUR attractions that you can recommend. (4)

5.3.7 The province that will be visited during this tour, shares borders with THREE countries. Name these THREE countries. (3)

5.3.8 What advice can you give tourists about the climate if they undertake this tour in September? (2)

5.3.9 Name THREE of the tourist regions that will be visited during this tour. (3)
[40]

Copyright reserved

QUESTION 6

6.1 Choose an item from COLUMN B that matches a description in COLUMN A. Write only the letter (A–J) next to the question number (6.1.1–6.1.10) in the ANSWER BOOK.

	COLUMN A		COLUMN B
6.1.1	Origins of Johannesburg	A	Mokhotlong
6.1.2	The place of the Bald Ibis	B	Vanderbijlpark
6.1.3	Cannibal Caves	C	Union Buildings
6.1.4	Skiing in July and August	D	King Moshoeshoe II
6.1.5	Pony-trekking centre	E	Enoch Sontonga Memorial
6.1.6	Only industrial museum in the country	F	Molimo Nthuse
		G	Mohale's Hoek
6.1.7	Situated in Meintjeskop and designed by Sir Herbert Baker	H	The farm Randjieslaagte
		I	Oxbow
6.1.8	Erected to remember those who died during the political conflict in the early 1990s	J	Thokoza Memorial
6.1.9	Memorial to the author of Nkosi Sikelele Africa		
6.1.10	First constitutional Monarch in Lesotho		

(10 × 1) (10)

6.2 Complete the following sentences by filling in the missing word(s). Write only the word(s) next to the question number (6.2.1–6.2.7) in the ANSWER BOOK.

6.2.1 Kimberley was established in … and was first known as … . (2)

6.2.2 Kathu means … . (1)

6.2.3 South Africa's oldest continuously operating bar, the … is situated in … . (2)

6.2.4 The Kgalagadi Transfrontier Park was previously known as the … Park and was combined with Botswana's … . (2)

Copyright reserved

6.2.5 The name of the town De Aar comes from the … . (1)

6.2.6 The … Statue in Upington commemorates the 'mounties' who used camels to patrol the desert. (1)

6.2.7 The Augrabies Waterfalls is in the … river. (1)

6.3 Read the itinerary below and answer the questions that follow:

Tour Package - 4 Day Simply the Best Safari and Panorama Route

Categories: Big 5/Birdwatching/Wildlife
2 nights – Kruger National Park – Skukuza Rest camp or similar 1 night – Private game lodge – 4 Star Luxury Lodge

At a glance
Tour duration: 4 days/3 nights
Min/max group size: Minimum of 2 people per tour
Tour departs from Johannesburg or Pretoria
Price from R10 990 per person

Tour Itinerary

01

DAY 1: JOHANNESBURG OR PRETORIA TO KRUGER NATIONAL PARK

Start your tour from Johannesburg or Pretoria in the comfort of an air-conditioned microbus and travel east towards the Southern Section of the Kruger National Park and arrive at the town of Hazyview in time for lunch. Your guide will change vehicles and prepare your specially adapted 4x4 open vehicle for your safari experience.

After lunch you will travel a short distance into the world renowned Kruger National Park for 2 nights.

On arrival at your accommodation situated in the heart of the national park, you will check into your air-conditioned, en-suite chalet before departing on your first open vehicle 4x4 safari drive in search of the many animals that inhabit the Kruger National Park.

In the late evening a full buffet dinner is enjoyed in the restaurant before retiring to your air-conditioned room for the night.
Overnight: *- Kruger National Park - Skukuza Rest camp or Similar*

Copyright reserved

02

DAY 2: KRUGER NATIONAL PARK

There will be an early morning wake-up call from your guide and then you will travel to the Southern reaches of the park that span over 350 km. The fresh air, morning game drive is spent travelling alongside river beds, visiting dams (lakes) that are frequented by animals, hoping to find the members of the Big 5 (Lion, Leopard, Buffalo, Rhino and Elephant) and various birds, mammals and reptiles that forage in the growth.

Breakfast is served at one of the many rest camps in the park before returning to your accommodation for mid-day relaxation time.

In the late afternoon your guide will take you on another game drive in search of animals that have eluded you on your previous game drive.

Dinner is once again enjoyed at the restaurant as you reflect on the sightings of animals during a fun-filled day on an open 4x4 safari vehicle.
Overnight: *- Kruger National Park - Skukuza Rest camp or Similar*

03

DAY 3: KRUGER NATIONAL PARK TO PRIVATE GAME LODGE

After a sumptuous breakfast at your accommodation, you will leave the comfort of your air-conditioned chalet and travel the short distance out of the Kruger National Park and embark on a morning guided tour of the Panorama Route seeing the magnificent Blyde River Canyon and the Three Rondavels, God's Window, the Lisbon or Berlin waterfall. There are African markets at various places along the Panorama Route and there will be time for passengers wishing to buy curios. You will arrive at the luxurious 4 star lodge and check in to your accommodation and in time for your afternoon game drive, this drive is conducted by your nature guide and a tracker in an open 4x4 vehicle on the private game reserve property, home to all the Big 5 and numerous fauna and flora.

An iced drink is enjoyed as you watch a true African sunset over the vast open lands of Africa.

You return to the lodge after sunset, thus giving you a possibility of viewing animals with a spotlight at night.

A 5 star dinner is freshly prepared by the highly acclaimed and experienced chef at the lodge.
Overnight: *Private Game Lodge*

04

DAY 4: PRIVATE GAME LODGE TO JOHANNESBURG OR PRETORIA

Awake in the early morning with an early morning 3 hour open vehicle drive and have the opportunity to view the game up close in their natural habitat as the Safari Lodge boasts a wide diversity of prolific game in the private conservancy. After a leisurely breakfast at the lodge it is time to make your way back home through the mighty Drakensberg Escarpment. Arrive in Johannesburg at about 17:00 after an unforgettable 4-day experience.

Copyright reserved

6.3.1 Tourists with an interest in …, … and … will enjoy this tour. (3)

6.3.2 The tour plan indicates that tourists will enter the Kruger National Park after their visit to Hazyview. Which Kruger National Park entrance gate is the nearest to Hazyview? (1)

6.3.3 If you are a tourist guide on this tour, explain what you will tell the group about the following attractions:

(a) Blyde River Canyon (2)

(b) Three Rondavels (2)

(c) God's Window (2)

(d) Lisbon and Berlin waterfall (2)

6.3.4 Identify the following attractions that a tourist will see during this tour. Write only the answer next to the letter (a–d) in the ANSWER BOOK.

(a)



(1)

(b)



(1)

Copyright reserved

(c)



(1)

(d)



(1)

6.3.5 Name TWO of the tourist regions in Mpumalanga through which tourists on this tour will travel. (2)

6.3.6 Mpumalanga's own arts festival, ... (name of festival) takes place every year in ... (town). (2)

[40]

Copyright reserved

QUESTION 7

7.1 Name the THREE South African provinces that border Lesotho. (3)

7.2 Name the capital city of Lesotho. (1)

7.3 What is the national plant of Lesotho? (1)

7.4 Indicate in which province/country each of the following attractions are and explain what it entails.

7.4.1 Forbes Reef (3)

7.4.2 Lion Cavern (3)

7.4.3 Silebe Rock (3)

7.4.4 Peperbus (3)

7.4.5 Salpeterkop (3)

7.5 You work at the Tourism Information Centre at OR Tambo International Airport. Mr and Mrs Merk arrive from England and they ask you to assist them with the following:

7.5.1 Briefly explain the economic activities of Gauteng to Mr and Mrs Merk. (3)

7.5.2 The Merk family would like to visit Johannesburg for one day. Draw a 1-day itinerary for their visit.

Mark allocation will be as follows:

- Organisation of itinerary (1)
- Identification of at least FOUR places of interest (4)
- Provision for meals and body breaks (1)
- Viability in terms of time (2)
- Provision of additional information such as safety and security tips (2)

Copyright reserved

7.5.3 Study the list of attractions below and identify FIVE natural attractions in Pretoria.

- Air Force Museum
- Anton van Wouw House
- Aquarium and Reptile House
- Art Collections of the University of Pretoria
- Austin Roberts Bird Sanctuary
- Church Square
- Church Street
- City Hall
- Ditsong National Museum of Natural History
- Groenkloof Nature Reserve
- Fort Klapperkop
- Fort Schanskop
- Freedom Park
- Kruger House
- National Cultural History Museum (previously called the African Window)
- National Zoological Gardens (5)

7.5.4 Name the TWO attractions below. Write only the answer next to the letter (a–b) in the ANSWER BOOK.

(a)



(1)

(b)



(1)
[40]

TOTAL SECTION B: 160
GRAND TOTAL: 200

Copyright reserved

ADDENDUM A

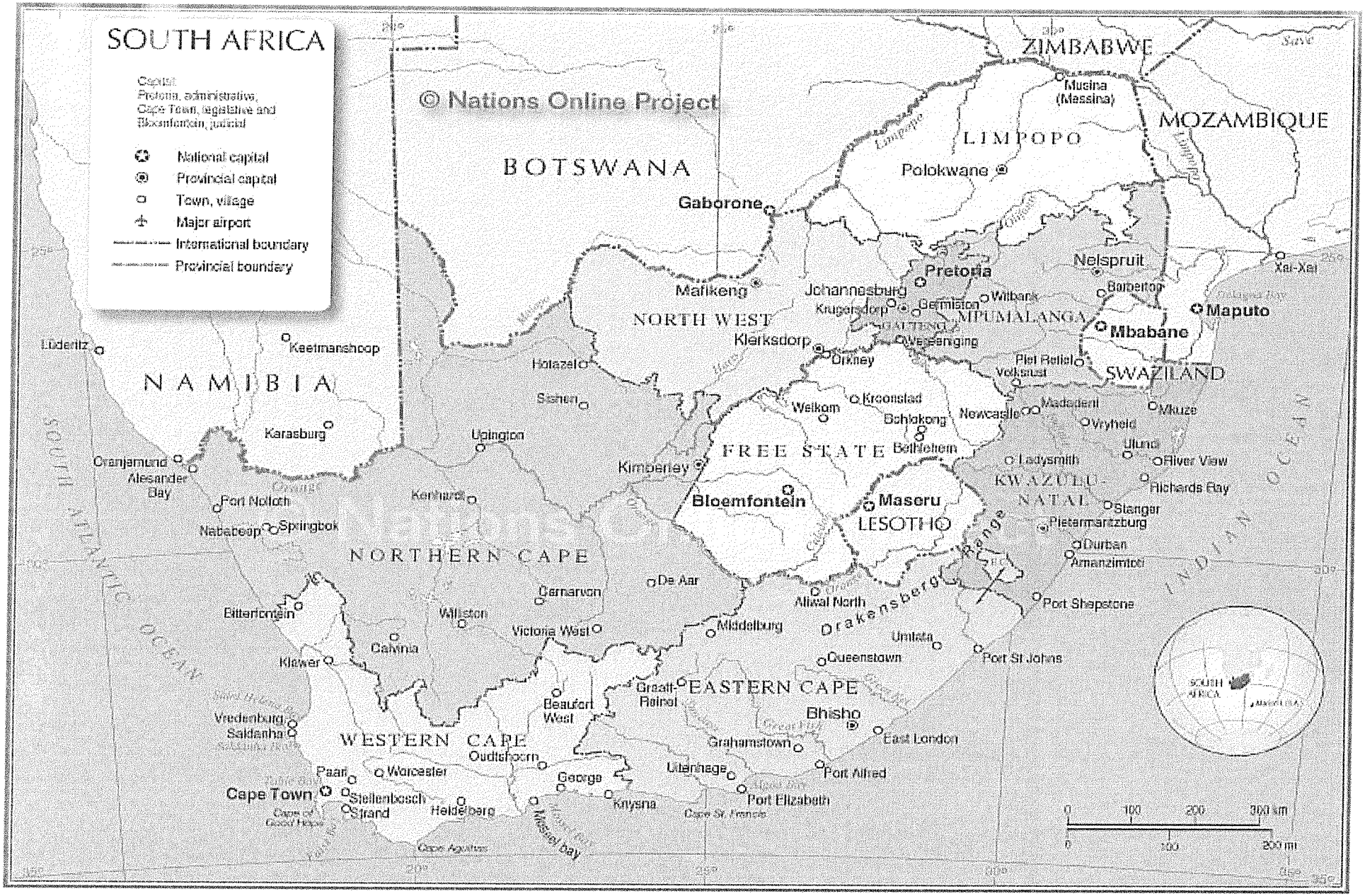

Copyright reserved

Please turn over