higher education & training

Department:
Higher Education and Training
REPUBLIC OF SOUTH AFRICA

N1410(E)(J11)H
JUNE EXAMINATION

NATIONAL CERTIFICATE

TOURIST DESTINATIONS N4

(22030044)

11 June 2014 (X-Paper)
09:00–12:00

THIS IS AN OPEN- BOOK EXAMINATION.

Calculators may be used.

Candidates may take any resources into the examination venue: student portfolio, textbooks, atlas, GSA magazine (February issue).

15 minutes reading time is allowed before the examination commences.

This question paper consists of 22 pages and 4 addenda.

BUSINESS STUDIES

Copyright reserved

DEPARTMENT OF HIGHER EDUCATION AND TRAINING
REPUBLIC OF SOUTH AFRICA

NATIONAL CERTIFICATE
TOURIST DESTINATIONS N4
TIME: 3 HOURS
MARKS: 200

NOTE: If you answer more than the required number of questions, only the required number of questions will be marked. All work you do not want to be marked must be clearly crossed out.

INSTRUCTIONS AND INFORMATION

1. Answer ALL the questions in SECTION A.
2. Answer any FOUR questions in SECTION B.
3. Read all the questions carefully.
4. Number the answers according to the numbering system used in this question paper.
5. Start each question on a NEW page.
6. Write neatly and legibly.

BUSINESS STUDIES

Copyright reserved

SECTION A (COMPULSORY)

QUESTION 1: MAP WORK

Make use of the map of the world (attached as ADDENDUM A) as well as your own atlas to answer the following questions:

1.1 Identify the type of map. (1)

1.2 Explain what kind of information you will be able to obtain from this map. (2)

1.3 Name TWO aims of this map. (2)

1.4 Use the map attached as ADDENDUM B to provide the latitude and longitude readings for the countries below. Write only the latitude and longitude readings of the countries next to the question number (1.4.1 – 1.4.2) in the ANSWER BOOK.

1.4.1 Brazil

1.4.2 Mongolia

(2 x 2) (4)

1.5 Name ONE of the ways in which the scale of a map can be shown. (1)

1.6 Identify the conventional map symbols below. Write only the answer next to the question number (1.6.1 – 1.6.2) in the ANSWER BOOK.

1.6.1



1.6.2 ____ ... ____ ... ____ (2 x 2 (4)

1.7 Mr and Mrs Meiser from Germany are celebrating their wedding anniversary in South Africa. The tourist office at Cape Town International Airport provided them with the map of South Africa (attached as ADDENDUM C) to plan their trip. They are travelling by car from Cape Town to Gauteng along the national road.

1.7.1 Mr and Mrs Meiser decided that they do not want to travel on the N1 and that they would like to visit Upington on their way to Gauteng.

What are the numbers of the TWO national roads that they will use to travel to Gauteng via Upington?

BUSINESS STUDIES

1.7.2 They would also like to include a visit to Durban in their itinerary.

How many kilometres will the clients travel from Johannesburg to Durban? Indicate the compass direction that they will be travelling in.

(2 x 2) (4)

1.8 Make use of the map attached as ADDENDUM D and your own atlas to identify the features marked A–G. Write only the answer next to the letter (A–G) in the ANSWER BOOK.

A Country
B Lake
C Sea
D Capital City
E Desert
F River
G Mountain

(7 x 1) (7)
[25]

QUESTION 2: SOUTHERN AND SOUTH AFRICA

Consult your atlas and learning material to answer the questions below. Write only the answer next to the question number (2.1–2.7) in the ANSWER BOOK

2.1 Name the national tree of South Africa. (1)

2.2 Name THREE of the countries with which South Africa shares its northern borders. (3)

2.3 Identify the following world heritage sites in South Africa:

2.3.1



Clue: The gateway city is Krugersdorp

BUSINESS STUDIES

Copyright reserved

2.3.2



Clue: The gateway town is Springbok (2 x 2) (4)

2.4 The climate in South Africa differs in different regions.

Identify THREE climate areas in South Africa. (3)

2.5 Name the TWO most important river systems in South Africa. (2)

2.6 Give ONE reason why South Africa is known as the *Rainbow Nation*. (1)

2.7 What public holiday in South Africa is celebrated annually on 21 March? (1)

[15]

TOTAL SECTION A: 40

SECTION B

Answer any FOUR questions in SECTION B.

QUESTION 3

3.1 Complete the following sentences by filling in the missing word(s). Write only the word(s) next to the question number (3.1.1–3.1.7) in the ANSWER BOOK.

3.1.1 Lesotho received independence status from …(country). (1)

3.1.2 The TWO most important traditional ceremonies in the eyes of the people of Swaziland are the … and the …. (2)

3.1.3 The town Thabazimbi in Limpopo was established as a result of the discovery of … (1)

3.1.4 The Motlatse Canyon, previously known as the Blyde River Canyon, was formed by the…river and is the … largest canyon in the world. (2)

3.1.5 The deepest gold mine in the world, called the …, is situated in Merafong City. (1)

BUSINESS STUDIES

Copyright reserved

3.1.6 The capital city of North West is …, which means …. (2)

3.1.7 A mission station that was established by Dr ….and his wife is situated in Kuruman. (1)

3.2 Choose an attraction from COLUMN B that matches a town/city in COLUMN A. Write only the letter (A–H) next to the question number (3.2.1–3.2.5) in the ANSWER BOOK.

COLOMN A		COLOMN B	
3.2.1	Upington	A	Debora Retief garden
3.2.2	Harrismith	B	coach houses
3.2.3	Howick	C	Moravian mission station
3.2.4	Middelburg, Eastern Cape	D	Kalahari-Oranje museum
3.2.5	Wupperthal	E	toposcope
		F	Midmar resort
		G	Grootfontein college of agriculture
		H	wheat industry museum

(5 x 2) (10)

3.3 You work for Compass Travel Agency in Johannesburg. Mr Brian Anderson contacted the agency and asked you to prepare a 10-day itinerary for a group of retired friends from England. They want to experience the nature and culture of the Limpopo Province.

3.3.1 Name the UNESCO World Heritage site situated in Limpopo that can be incorporated in their itinerary. (1)

3.3.2 Name any THREE nature reserves/national parks that the group can visit in the Waterberg District of Limpopo. (3)

3.3.3 Mr Anderson indicated that they are especially interested in the Venda culture.

Name THREE cultural attractions in and around Thohoyandou that you can recommend to him. (3)

BUSINESS STUDIES

3.3.4 Name TWO of the five official tourism regions of the Limpopo Province. (2)

3.3.5 Name the mountain range which lies north of Louis Trichardt. (1)

3.3.6 Compile a 1-day itinerary for the group for their visit to Polokwane. (Remember their interests.)

Mark allocation will be as follows:

Organisation of itinerary	(1)
Identification of at least 4 places of interest	(4)
Provision made for meals and body breaks	(1)
Viability in terms of time	(2)
Provision of additional information such as safety and security tips	(2)
	[40]

QUESTION 4

4.1 Name THREE of Lesotho's border posts. (3)

4.2 Name TWO of the tourism regions in the Western Cape. (2)

4.3 You have to advise tourists regarding *natural* attractions in Paarl.

List FIVE natural attractions in and/or around Paarl. (5)

4.4 Answer the questions about the following attractions:

4.4.1 Buysdorp

4.4.1.1 Where is it situated? (1)

4.4.1.2 Is it a natural or man-made attraction? (1)

4.4.1.3 Describe the attraction. (3)

4.4.2 Goetz/Fleishack Museum

4.4.2.1 Where is it situated? (1)

4.4.2.2 Is it a natural or man-made attraction? (1)

4.4.2.3 Describe the attraction. (3)

BUSINESS STUDIES

Copyright reserved

4.5 Consult the extract of an itinerary below and answer the questions.

5-day tour from Durban to Johannesburg - travel up Sani Pass and visit the Kingdom of Lesotho, the majestic Drakensberg Mountains, Midlands Meander and take a hike to see the magnificent bushman paintings of the San people.

From the renowned beaches of Durban to the bustle of this multicultural city, you'll be climbing way, way up into the highest, most challenging vehicle pass in the country, Sani Pass in the mountain Kingdom of Lesotho. It's an unforgettable ride, and when you're up there, we treat you to a lunch at the highest pub in Africa!

Highlights:
Enjoy the spectacular views from a Sky Car on the top of the fabulous Moses Mabhida Stadium.
Join the locals in enjoying Durban's revitalized Golden Mile.
Experience the highest vehicle pass in Southern Africa.
Visit the Kingdom of Lesotho.
Tour the Midlands Meander Arts & Crafts Route.
View the majestic mountains in the Drakensberg - A World Heritage Site.
View 2,000-year-old Bushman paintings.
Enjoy scenic hiking trails.

Please note: Visa conditions apply for Lesotho and passports are required.

Day 1: (Sat) Durban



Welcome to Durban, city of many-faceted cultures, exquisite beaches and seaside weather. We meet you off your flight into King Shaka International Airport, and ensure your transport to our comfortable hotel, set on the revitalized beachfront stretch of the Marine Parade. We've organized an orientation City Tour, leaving at 14:00, and then, for a panoramic bird's-eye view of the City and surrounds, you'll take your seat on our Moses Mabhida Football Stadium Sky Car! As the sun sets, you'll have the remainder of the day to enjoy the beachfront promenade, and enjoy the constant stream of action which parades along this seaside strip.
Accommodation: Protea Edward or similar

Day 2: (Sun) Durban / Lesotho



We leave Durban by 06:30 this morning, heading towards the village of Underberg at the foot of the Southern Drakensberg Mountains. Here we transfer to 4x4 vehicles, tough enough to climb the highest vehicle pass in Southern Africa. The views from Sani Pass are utterly spectacular and can't help but make a lasting impression on first-timers. At the top is the border post between South Africa and Lesotho, thus passports are a must. Once inside Lesotho, we visit a Sotho tribal village, and interact with local people before enjoying lunch (own account) at the highest pub in Africa. Perched right near the edge of the mountain, it has few rivals in terms of pub views. Thus fortified, we wind our way gently back down the mountain, and with all that fresh air, we'll be looking forward to putting up our feet and settling into our accommodation.
Accommodation: Drakensberg Gardens or similar

Copyright reserved

Day 3: (Mon) Drakensberg Mountains



This morning, we amble through the glorious southern berg to the Royal Natal National Park and we do so through the lush green Midlands Meander area. Here, numbers of city folk have chosen to swap stress for the slow lane, and work with arts and crafts; this country area is filled with quality enterprises - a number of them recognized internationally - and we'll be stopping for a little shopping. Our overnight accommodation is set in this magnificent park, and we've given you the afternoon at leisure to explore those aspects which most interest you. The Royal Natal National Park is renowned for its spectacular scenery and wonderful mountain trails which reach into the heart of the KwaZulu-Natal nature reserve. For walkers and hikers, there are short excursions; for those content to absorb the beauty of the Drakensberg, there's the Amphitheatre, a 5-kilometre-long, 500-metre-high rock wall, and above the rock face, Mont-Aux-Sources peak where the Orange River journeys west across South Africa to the Atlantic Ocean. The Thukela (Tugela) River - boasting one of the highest waterfalls in the world - cascades down the rock face as it heads east to the Indian Ocean. In a nutshell, the scenery is breathtaking.
Accommodation: Mont-Aux-Sources Hotel or similar

Day 4: (Tue) Drakensberg Mountains



After breakfast we set off on a leisurely round trip hike to age-old Bushman paintings (average level of fitness required), at a site which was once home to South Africa's earliest inhabitants, the San people, better known as Bushmen. Enjoy a fascinating tour of the rock paintings, which remain on the cave walls as clues to the San's simple lifestyle. Now you can choose - we all return to our accommodation at Mont-Aux-Sources Hotel, and you can either have a leisurely afternoon soaking in the beauty, or strap on those hiking boots, and take to the mountains again for an afternoon hike.
Accommodation: Mont-Aux-Sources Hotel or similar

Day 5: (Wed) Durban / Johannesburg

We tuck into a wonderful mountain breakfast, and we're all set for our road trip back to Johannesburg. Sit back and enjoy the scenery, and we'll be back mid-afternoon.

2013 Departure dates:	Per Person Sharing	Single Room
19/01, 02/02, 16/02, 02/03, 16/03, 30/03, 13/04, 27/04:	R10 150	R11 990
11/05, 25/05, 08/06, 22/06, 06/07, 20/07, 03/08, 17/08, 31/08:	R9 570	R11 375
14/09, 28/09, 12/10, 26/10:	R10 510	R11 990
09/11, 23/11, 07/12, 21/12:	R10 505	R12 440

Copyright reserved

Includes:
- 4 breakfasts
- 1 lunch
- 1 dinner
- Airport Transfers
- Hotel Porterage

Please note:
No child U8 allowed on tour.
Minimum 2 people - no maximum.
*Please note visa conditions apply for Lesotho and passports are required.

4.5 4.5.1 One of the tourists indicates that he does not want to enjoy the beach in the afternoon of the first day and would rather visit some of the museums in Durban.

List THREE of the museums that he can visit. (3)

4.5 2 What is the price of this tour per person sharing for tours departing in September? (1)

4.5.3 Name TWO aspects included in the rate. (2)

4.5.4 Name TWO of the attractions that can be seen in the Royal Natal National park. Refer to the extract. (2)

4.5.5 Why do tourists need to bring their passports with when they go on this tour? (1)

4.5.6 The town Underberg is the eco-tourist centre of the Southern Drakensberg.

Name THREE tourist activities that Underberg is known for. (3)

4.5.7 What is the main mode of transport that is used by the locals in Lesotho? (1)

4.5.8 What is the minimum number of tourists that need to book for the tour before it will take place? (1)

4.5.9 On the way back to Gauteng tourists will pass Dundee, which is known for various battle sites.

List THREE of the battle sites in and around Dundee. (3)

BUSINESS STUDIES

Copyright reserved

4.5.10 One of the tourists on the tour decides to extend his stay by spending another two days in Gauteng. He asks you to be his tourist guide and indicates that he wants to see some of the attractions in Gauteng. You decide to take him to the THREE attractions listed below.

Give ONE reason why each of these THREE attractions justifies a visit.

4.5.10.1 Lipizzaners

4.5.10.2 Munsieville

4.5.10.3 Lane of Fame

(3 x 1) (3)
[40]

QUESTION 5

Indicate whether the following statements are TRUE or FALSE. Choose the answer and write only 'true' or 'false' next to the question number (5.1.1–5.1.10) in the ANSWER BOOK.

5.1 5.1.1 Hermanus is one of the best places to visit if one wants to see Southern Right Whales.

5.1.2 The Aardklop Arts Festival takes place in Oudtshoorn every year.

5.1.3 The village Haga-Haga is situated in the Northern Cape.

5.1.4 A chair monument can be seen in the Eastern Cape town, Middelburg.

5.1.5 South Afrika has two language monuments for the Afrikaans language, one in Burgersdorp and one in Worcester.

5.1.6 Teebus and Koffiebus are sandstone formations in the Eastern Cape.

5.1.7 The Xhosa name for Durban is Thekwini.

5.1.8 The Eye of Zastron is a pub in Zastron.

5.1.9 The Phakisa Raceway in Welkom provides entertainment for all racing enthusiasts.

5.1.10 The SALT telescope is situated outside Sutherland in the Northern Cape.

(10 x 1) (10)

BUSINESS STUDIES

Copyright reserved

5.2 Various options are provided as possible answers to the following questions. Choose the answer and write only the letter (A–D) next to the question number (5.2.1–5.2.10) in the ANSWER BOOK.

5.2.1 The Castle of Good Hope is situated in ....

A Durban.
B Langebaan.
C L'Agulhas.
D Cape Town.

5.2.2 Irma Stern was a South African ...

A architect.
B sculptor.
C painter.
D dancer.

5.2.3 Ceres is especially known for the packing and drying of ...

A sugar.
B vegetables.
C fruit.
D maize.

5.2.4 The town Mthatha is associated with the ... cultural group.

A Zulu
B Sotho
C Swazi
D Xhosa

5.2.5 A Khoisan Cultural Village can be visited near ...

A Tweeling.
B Tsitsikamma.
C Willowmore.
D Reitz.

5.2.6 Kosi Bay consists of ... lakes that feed into the ocean.

A 4
B 7
C 9
D 5

BUSINESS STUDIES

Copyright reserved

5.2.7 Talana Museum is situated in …

A North West.
B Gauteng.
C Kwazulu-Natal.
D Free State.

5.2.8 Clarens is also known as the … of the Free State.

A jewel
B star
C basket
D flower

5.2.9 Kathu is situated close to a/an … mine.

A gold
B diamond
C iron ore
D coal

5.2.10 Kroondal is known for its …. community.

A Italian
B German
C Portuguese
D Spanish

(10 x 1) (10)

5.3 Read the itinerary below and answer the questions that follow.

NAMAKWALAND WILDFLOWER Region Tour



Day 1: Northern Cape wine region

We depart from Pretoria at 05:00. We travel via the towns of Vryburg, Kuruman, Upington and Kakamas, where we spend our first night. This tour is done on a bed and breakfast basis. Lunch, dinner and drinks are for your own account.

BUSINESS STUDIES



Day 2: Augrabies

After breakfast we depart from Kakamas and travel through the Northern Cape towards the Orange River (Gariep River) region. We pass through the small but beautiful town of Keimoes, on our way to the Augrabies National Park. Augrabies - 'The place of great noise' lies at the heart of a remote and fascinating National Park. The great formations of granite confine the waters of the Gariep (Orange) River as it flows tantalizingly across the dry plains. We continue our travels to the town of Pofadder, where we have a brief lunch stop. We overnight in the Springbok area, on a private farm in the area of Nababeep or Kleinsee. Bed and breakfast included. Lunch, dinner and drinks for your own account.



Day 3: Springbok, Namakwa National Park

After breakfast we visit the attractive area of Springbok, Okiep, and Nababeep. At Nababeep we walk amongst the flowers and also have lunch and enjoy the cuisine of this region. We visit the well-known Goegap Nature Reserve and Namaqua National Park, where fields of flowers await us. We overnight in the area of Vredendal (or nearby) for two nights. Bed and breakfast basis. Lunch, dinner and drinks are for your own account.





BUSINESS STUDIES

Day 4: Nieuwoudtville, Vredendal

After breakfast we travel to the flower bulb capital of the world, Nieuwoudtville, where the bulb species grow on the Boland of the Namaqualand. A visit to the 100 m Nieuwoudtville Waterfall and the Quiver Tree Forest is a must. The Succulent Nursery in Vanrhynsdorp is also worth a visit. Overnight in Vredendal area, on a bed and breakfast basis. Drinks, dinner and lunch for your own account.



Day 5: Cedarberg, Clanwilliam

The Cedarberg Mountains, named after the cedar tree which is now threatened in this region.

After a well-deserved breakfast, we depart from Vredendal to the town of Clanwilliam. It is in this region where the much loved Rooibos tea is cultivated. A visit to the Rooibos tea factory, and also the Veldshoe Factory (vellies), is certainly a must. The Ramskop Nature Garden is another attraction not to be missed in Clanwilliam. After lunch we travel to Stellenbosch, where we overnight at the lovely Kleine Zalze Vineyard Estate, or in Cape Town. Overnight in Stellenbosch or Cape Town, on a bed and breakfast basis. Dinner, lunch and drinks for your own account.

Kleine Zalze Wineland and Lodge, Stellenbosch

Day 6: Back to Johannesburg, or your own destination.



This morning we have an early breakfast, after which we leave for Cape Town station. At 09:00 we depart on the luxury premier class train back to Johannesburg. On the train all meals are included with the accommodation.

BUSINESS STUDIES

Copyright reserved

Day 7: Arrive home

We arrive at Johannesburg station at 11:00 on Sunday morning.

Price R8 500,00 per person sharing. Single supplement R1 000,00. Included in this price are all entrances according to the itinerary, transport, train ticket back to Johannesburg, bed and breakfast. All meals on the train are included. You have a registered tourist guide on call.

The visiting order of the itinerary may change due to weather conditions, or the greater availability of flowers in other areas as well as the availability of specific accommodation. This tour may run the other way round, starting with the luxury train trip to Cape Town and returning via Vryburg on the last day.

5.3 5.3 1 Why is Augrabies known as 'the place of the great noise'? (2)

5.3.2 Name TWO of the minerals that are mined in the Vredendal area. (2)

5.3.3 Name TWO products that are made from the grapes that are produced in Kakamas. (2)

5.3.4 Which meals are included in this tour? (1)

5.3.5 In which tourism region of the Northern Cape is Upington situated? (1)

5.3.6 During the visit to Clanwilliam, some of the tourists indicated that they would like to see more of the Cederberg Wilderness.

Explain what makes these mountains unique. Give specific examples to motivate your answer. (4)

5.3.7 Stellenbosch is the ... (number) oldest town in South Africa, founded by ... in ... (date). (3)

5.3.8 The Nieuwoudtville Waterfall and the Quiver Tree Forest are situated in Nieuwoudtville.

Name TWO other attractions in and around Nieuwoudtville that can be visited. (2)

5.3.9 Name the THREE provinces that will be visited during this tour. (3)

[40]

BUSINESS STUDIES

Copyright reserved

QUESTION 6

6.1 Choose an item from COLUMN B that matches a description in COLUMN A. Write only the letter (A–J) next to the question number (6.1.1–6.1.10) in the ANSWER BOOK.

COLUMN A		COLUMN B	
6.1.1	King Shaka Memorial	A	Orania
6.1.2	City of roses	B	Johannesburg
6.1.3	Town built to accommodate construction workers	C	Soweto
6.1.4	Birth site of Archbishop Desmond Tutu	D	Klerksdorp
6.1.5	The house of the well-known poet Totius	E	Sabie
6.1.6	Top of Africa	F	KwaDuduza
6.1.7	South Western Townships	G	Simunye
6.1.8	Forestry Museum	H	Bloemfontein
6.1.9	Home of the rain-making queen, Modjadji	I	Potchefstroom
6.1.10	Sugar producing area	J	cycad reserve, Tzaneen

(10 X 1) (10)

6.2 Complete the following sentences by filling in the missing word(s). Write only the word(s) next to the question number (6.2.1–6.2.7) in the ANSWER BOOK.

6.2.1 The Buffalo City Metropolitan Municipality consists of East London, …, Mdantsane and … (2)

6.2.2 The town Mokhotlong in Lesotho lies high in the … mountains. (1)

6.2.3 The name Pietermaritzburg is a combination of the names of the two Voortrekker leaders … and … . (2)

6.2.4 The … Memorial, commemorating the Anglo-Boer War in Bothaville, is made of … in Italy. (2)

6.2.5 The Cango Caves are situated outside of … (1)

6.2.6 An Institute for the Blind and Deaf is situated in … (1)

6.2.7 The town Dordrecht is situated in … (province). (1)

BUSINESS STUDIES

Copyright reserved

6.3 Read the itinerary below and answer the questions.

Standard Kruger and Cape Town

Price from: R10 240 pp
Duration: 8 days

Summary: By popular demand we created this tour, what with Table Mountain recently being chosen as one of the New 7 Wonders of Nature, combined with the Kruger National Park, established in 1898 and one of the largest game reserves in Africa, 360 km from north to south and 65 km from east to west. The accommodation is three-star with crisp service and ideally located. The Safari provides a combination of private game drives that permit the rangers to get real close by, going off-road when necessary for the 'must-see' wildlife like lions, hyenas, cheetah, rhinos and elephants. The full-day Kruger Park game drive provides the contrast with the extensive road system and the abundance of mammals, birds and reptiles.

The flights and the number of days may vary according to your preferences, but these itineraries used by other clients will hopefully serve as an idea.

Day 1: **Arrive Johannesburg**
You will be met upon arrival at O.R.Tambo airport and transferred to Sunrock Guest House for dinner, bed and breakfast.

Day 2: Johannesburg to Private Game Lodge

At 06:15 you will be transferred to a hotel a few kilometres down the road to meet the shuttle bus that will take you from Johannesburg and head for the Greater Kruger Park area, arriving at Thornhill Safari Lodge just after lunch. We settle into camp after which you have the option to go on a late afternoon/evening game drive in open 4x4 vehicles. Sundowner drinks are enjoyed at one of the waterholes before continuing our game drive into the night. After an exciting evening, we return to camp to enjoy a traditional South African meal around the log fire. (Includes dinner)

Day 3: Private Game Lodge to Kruger National Park

An early rise, as we make our way to the world-renowned Kruger National Park. We enter the Kruger Park through one of the central gates, where our wildlife experience unfolds. We enjoy breakfast at one of the picnic spots before continuing through the Park. The entire day will be spent game viewing, bird watching and stopping off at the various waterholes en route. Our safari takes us along some of the best game drive routes that Kruger has to offer. We depart from the Park at sunset and return to the Lodge for an evening of relaxation. (Includes breakfast & dinner)



Day 4: Private Game Lodge to Private Game Lodge

After a hearty breakfast we spend the day at leisure, relaxing at the Lodge or taking part in the various optional activities on offer. We end the day with a late afternoon/evening game drive. Guided by spotlights, we track the elusive creatures of the night, after which we return to the Lodge to enjoy a boma dinner. (Includes breakfast, lunch & dinner)

BUSINESS STUDIES

Copyright reserved

Day 5: Private Game Lodge to Cape Town

After an early morning wake-up we venture out on a morning nature walk. Escorted by qualified rangers, we get skilled in nature's finer details like bird, tree & spoor identification. We enjoy brunch at the Lodge prior to driving along the Drakensberg Escarpment to view the impressive Three Rondawels overlooking the Blyde River Canyon. (Includes breakfast)

After that we continue our journey to Johannesburg, arriving back at O.R. Tambo airport in the late afternoon where you should make your way to check-in an hour before departure.

Depart Johannesburg, O.R. Tambo airport on MN 109 at 19:25.

Arrive Cape Town at 21:35.

You will be met at the airport and transferred to the Inn on the Square Hotel, Green Market Square, Cape Town where a double room has been reserved for 4 nights with breakfast included. Offering comfortable en suite rooms, there are also interleading rooms for families, air-conditioning, a safe, a hair dryer, cable TV and all the mod cons that you would expect from a good three-star hotel. It is very conveniently located on Greenmarket Square which boasts stalls with mostly funky clothing, souvenirs, books, local crafted shoes and leather goods, as well as local and rasta music and always the entertainment of buskers and the informal sellers. Guests can also take advantage of the heated rooftop swimming pool and sundeck that has magnificent views of Table Mountain, and there is also a gym and sauna for those with extra energy to burn.



The Dish restaurant with an alfresco terrace overlooks the vibrant Greenmarket Square and serves breakfast, lunch and dinner with an extensive à la carte menu and a wide variety of other dishes, complemented by an impressive selection of local and imported wines. Before and after dinner you are invited to enjoy a cigar and a cognac in the Famous Cigar Lounge or choose from an extensive range of fine wines housed in the private cellar. Eating out in the City Centre these days is a truly cosmopolitan experience!

Heritage Square is a couple of blocks from the hotel and hosts a number of quality restaurants like Savoy Cabbage and Africa Café, which are but two of the six restaurants providing scrumptious delights. The famous Company Gardens, the Castle, the shopping mecca of St Georges Mall, Greenmarket Square and the new Rhodes Mandela Square are within walking distance.

Day 6: Cape Town City Tour and Table Mountain

After breakfast enjoy a Hop-on Hop-off City Sightseeing bus that will take you up to the Table Mountain cable car station, and from there take the 360 degree cable car ride up to the top of Table Mountain for a wonderful scenic view of the Cape Town surrounds. Afterwards take the City Sightseeing bus down to Camps Bay, where you can hop off for a walk on a beautiful white beach or have a snack to eat at one of the many sidewalk restaurants, then back onto the City Sightseeing bus and head to the V&A Waterfront that has something for everybody.

Day 7: Cape Town Peninsula Tour

You will be collected from your hotel and then begin the morning with a leisurely drive along the Atlantic Sea Board through Sea Point and Camps Bay with the 12 Apostles towering above us. When we arrive in Hout Bay you will have the opportunity to go on a glass-bottom boat trip to Duiker Island which is home to 20 000 Cape Fur Seals. We then drive along the scenic Chapman's Peak Drive towards the Cape of Good Hope Nature Reserve where you can stand at the most southwesterly tip of Africa, view the legendary meeting points of the Atlantic and Indian Oceans, and you may even have a chance encounter with a Chacma Baboon.

Copyright reserved



We then turn north and move onto the Boulders Beach penguin colony which is home to 5 000 African penguins. We carry on along the False Bay coast through the historical naval town of Simon's Town, the quaint fishing village of Kalk Bay, and the surfing suburb of Muizenberg. During the whale season, this drive allows you the perfect opportunity to spot these magnificent mammals of the deep. We then visit the beautiful Kirstenbosch Botanical Gardens to stroll through thousands of indigenous and exotic plants and admire the views over Cape Town. A perfect way to end a superb day tour.

Day 8: Cape Town

There is so much to do in Cape Town, with the best beaches, Clifton 1, 2, 3 & 4, the hottest place to be in summer. The V&A Waterfront is a short distance from the city, and so is the Sea Point promenade, where you will find skate boarders, roller-bladers, runners, ice-cream eaters, sunset admirers, in fact anyone interested in this stretch of beauty alongside the Atlantic ocean, so make the most of your last day before you are transferred to Cape Town airport for your flight home. Thank you for choosing to visit Africa and all she has to offer.

6.3.1 Some of the tourists arrive early on the first day and ask to be taken toSoweto.

List THREE of the attractions in Soweto that they can visit. (3)

6.3.2 Name the president that played an important role in the establishment of the Kruger National Park? (1)

6.3.3 If you are the tourist guide for a group on this tour, explain what you will tell them about the following attractions:

6.3.3.1 Long Tom Pass

6.3.3.2 Bourke's Luck Potholes

6.3.3.3 Bo-Kaap

6.3.3.4 Rhodes Memorial

(4 x 2) (8)

BUSINESS STUDIES

Copyright reserved

6.3.4 Identify the following attractions that a tourist will see during this tour:

6.3.4.1



6.3.4.2



6.3.4.3



6.3.4.4



(4 x 1) (4)

6.3.5 Name TWO forms of transport that will be used during this tour. (2)

6.3.6 Name the TWO provinces mainly covered by this tour. (2)

[40]

BUSINESS STUDIES

QUESTION 7

7.1 Describe the agricultural activities in the Free State province. (2)

7.2 Name the TWO official languages of Lesotho. (2)

7.3 Which country is completely landlocked by South Africa? (1)

7.4 Indicate in which province/country each of the following attractions are and explain what each attraction entails:

7.4.1 The Sentinel, Phuthaditjhaba

7.4.2 Cannibal Caves, Mohale's Hoek

7.4.3 Grand Valley, Nhlangano

7.4.4 Buyskop, Louis Trichardt

7.4.5 Mapoch Caves, Roossenekal

(5 x 3) (15)

7.5 You work at the Tourism Information Centre in Bloemfontein. Mr and Mrs Stevenson arrive from America and they ask you to assist them with the following:

7.5.1 List THREE of the tourism regions of the Free State province. (3)

7.5.2 The Stevenson couple would like to visit Clarens for one day.

Develop a 1-day itinerary for their visit.
Mark allocation will be as follows:

Organisation of itinerary	(1)
Identification of at least 4 places of interest	(8)
Made provision for meals and body breaks	(1)
Viability in terms of time	(2)
Provision of additional information such as safety and security tips	(3)

BUSINESS STUDIES

Copyright reserved

7.5.3 Identify the following TWO attractions in the Free State:

7.5.3.1



7.5.3.2



(2 x 1) (2)

[40]

TOTAL SECTION B: 160

TOTAL: 200

BUSINESS STUDIES

Copyright reserved

ADDENDUM A



Copyright reserved

ADDENDUM B

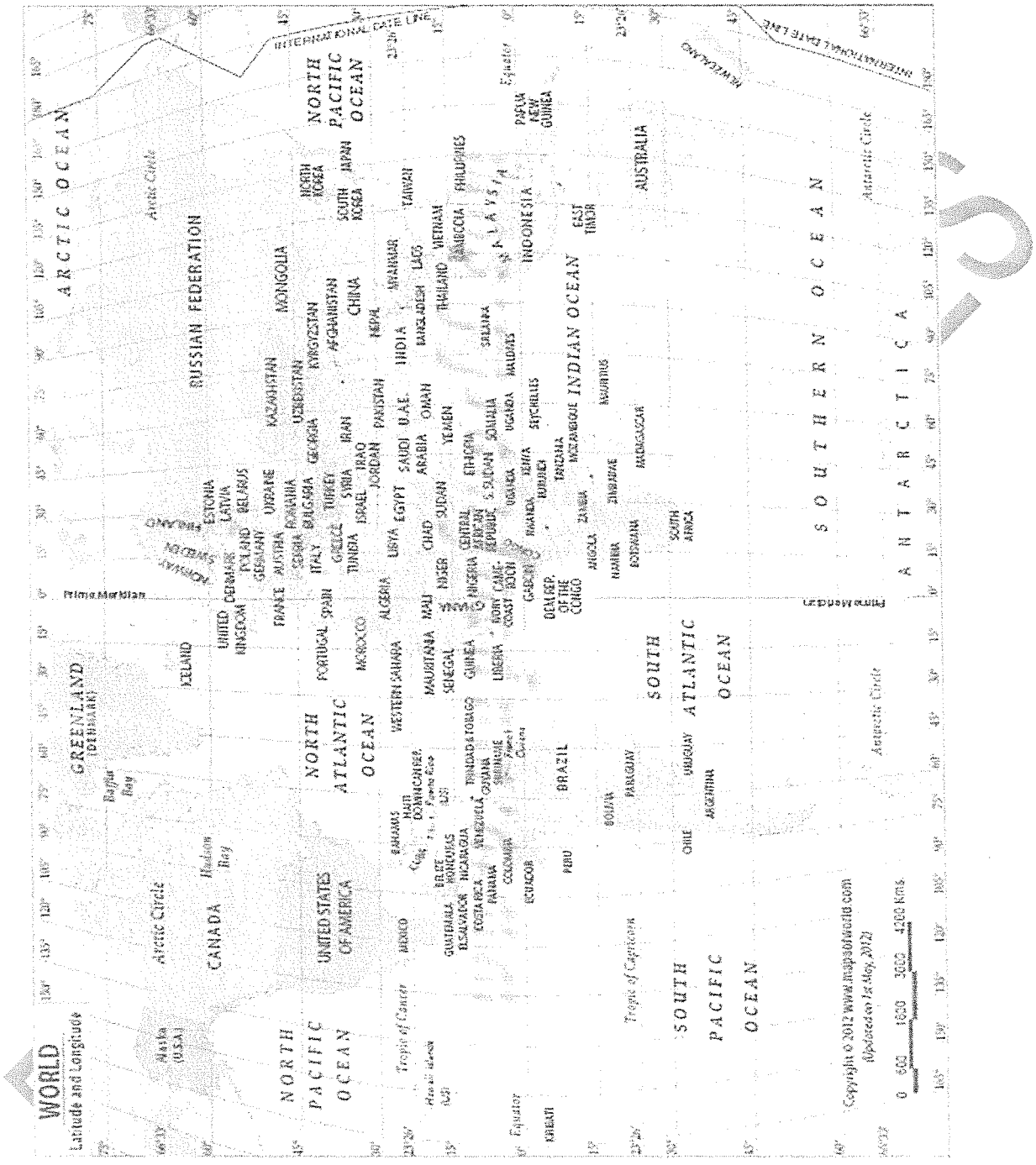
WORLD
Latitude and Longitude
ARCTIC OCEAN
NORTH PACIFIC OCEAN
NORTH ATLANTIC OCEAN
SOUTH PACIFIC OCEAN
SOUTH ATLANTIC OCEAN
INDIAN OCEAN
SOUTHERN OCEAN
RUSSIAN FEDERATION
CANADA
UNITED STATES OF AMERICA
GREENLAND
ICELAND
AUSTRALIA
INDONESIA
ANTARCTICA
Arctic Circle
Antarctic Circle
Tropic of Cancer
Tropic of Capricorn
Equator
Prime Meridian
INTERNATIONAL DATE LINE
Copyright © 2012 www.mapsofworld.com
Updated on 1st May, 2012
0 800 1600 2400 4200 Kms

ADDENDUM C

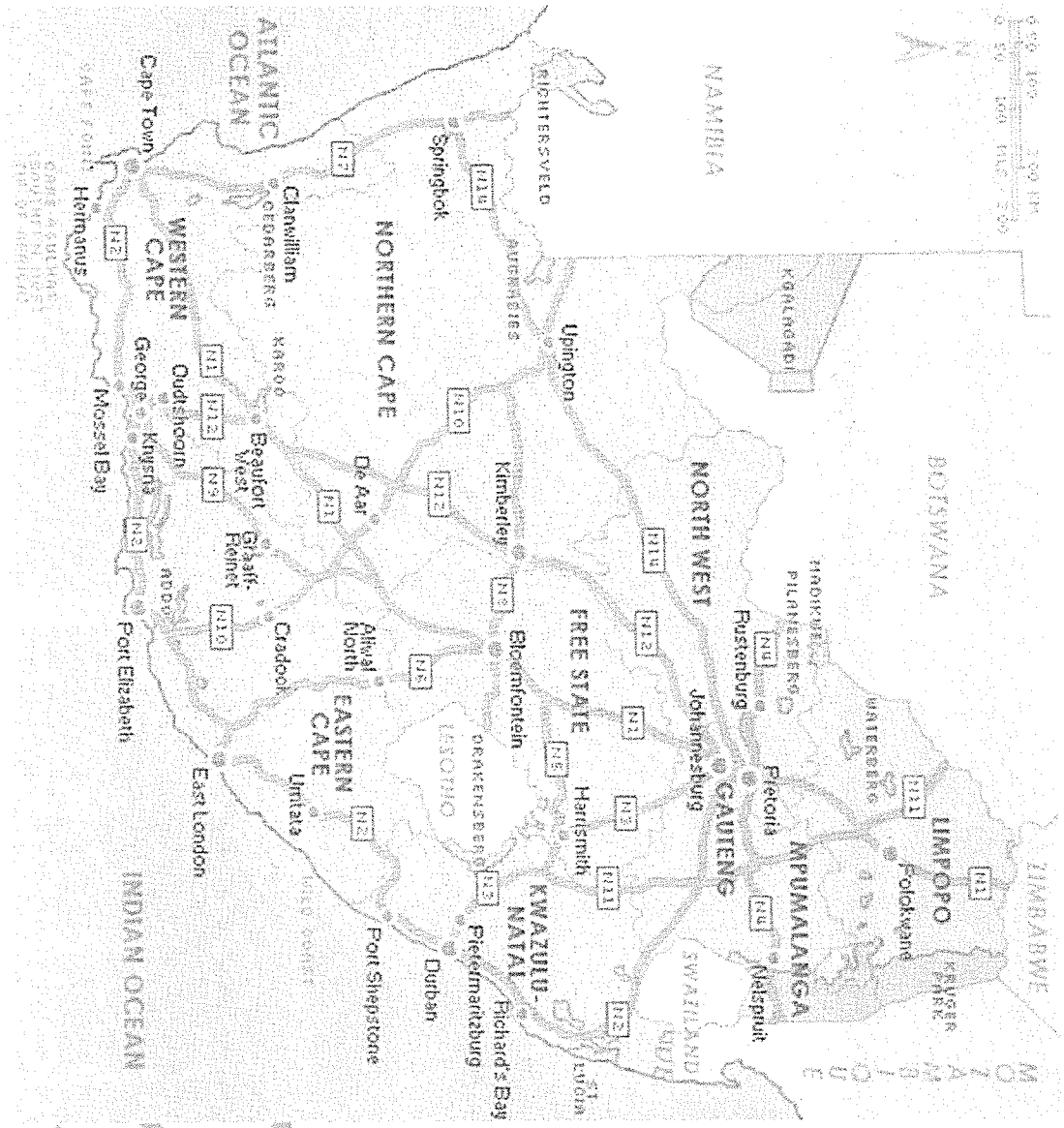

Copyright reserved

ADDENDUM D

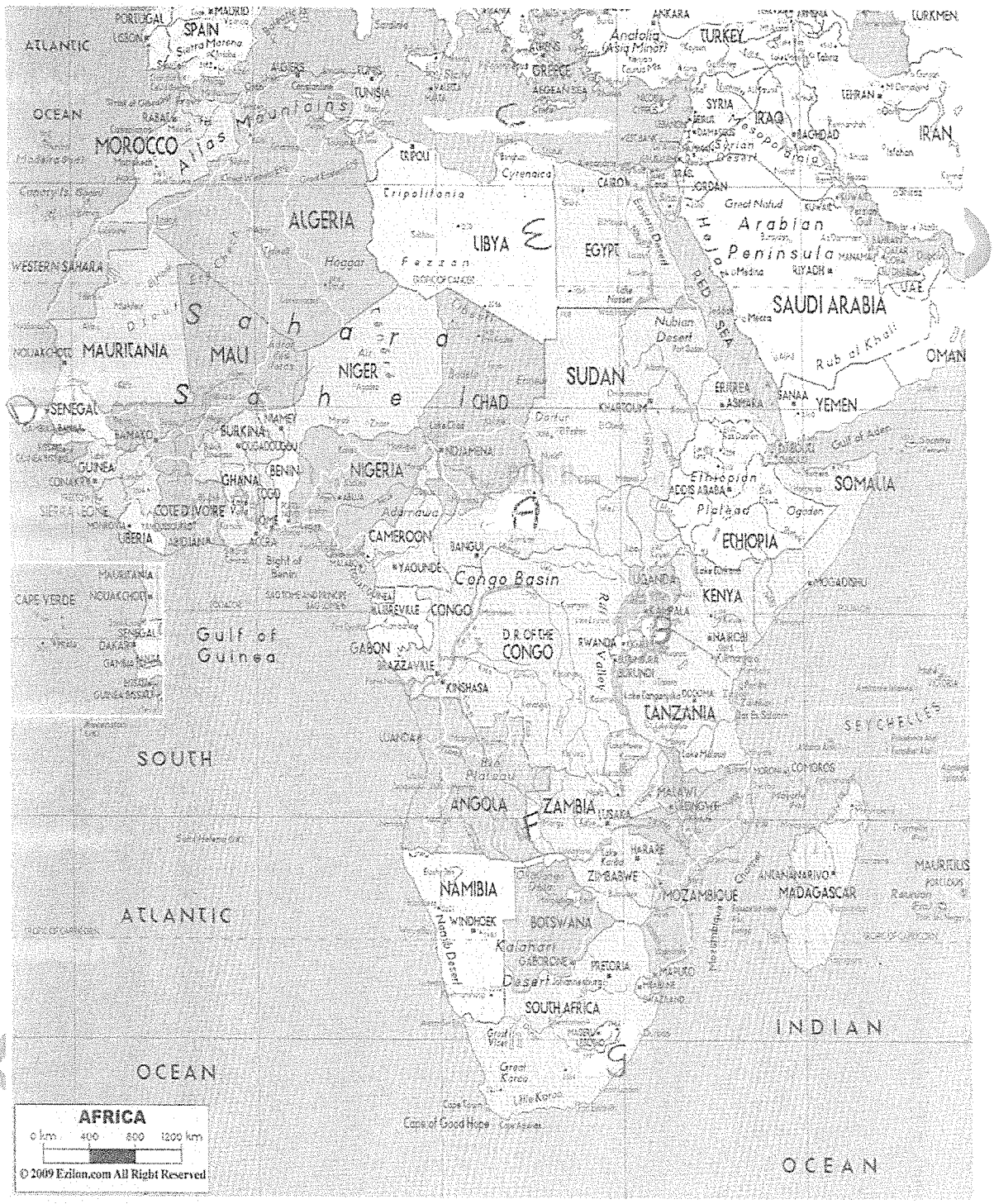

Copyright reserved